# Percent Error: How Close Are Your Estimates?

Explore ideas and representations

**Name** _____ **Date** _____ **Score** _____ / 8

**QUICK REVIEW**

The error fraction is $|\text{estimate} - \text{accepted}|/\text{accepted}$. Multiply by $100$ to get the percent number, then attach $\%$. An estimate $19$ cm for a $20$ cm object has $1$ cm absolute error and error fraction $1/20 = 0.05 = 5\%$. Use the accepted value below the fraction.

**Worked example**

Example ruler reading (cm): estimate $19$, accepted value $20$. Find absolute error and percent error.

**1.** Absolute error: $|19 - 20| = 1$ cm.
**2.** Use the accepted value $20$ cm as the denominator: $1/20 = \frac{1}{20}$.
**3.** The percent-error number is $\frac{1}{20}(100) = 5$; therefore the error is $5\%$.
**Answer:** Absolute error $1$ cm; percent error $5\%$.

## Practice Problems

Show your thinking.

**1.** Length in cm: estimate $48$, accepted value $50$. Find absolute error and percent error.

**2.** Mass in g: estimate $84$, accepted value $80$. Find absolute error and percent error.

**3.** Item count: estimate $95$, accepted value $100$. Find absolute error and percent error.

**4.** Volume in mL: estimate $126$, accepted value $120$. Find absolute error and percent error.

**5.** An accepted mass is $300$ g. Find the smallest and largest estimates allowed by a $5\%$ error limit.

**6.** For an accepted length of $300$ cm, two estimates are $285$ cm and $315$ cm. Do their percent errors differ?

**7.** Measuring tape (cm): estimate $58$, accepted value $60$. Find absolute error and percent error.

**8.** A length is accepted as $80$ cm. Find the largest estimate allowed by a $2.5\%$ error limit.

# Answer Key

1. Absolute error $2$ cm; percent error $4\%$.
2. Absolute error $4$ g; percent error $5\%$.
3. Absolute error $5$ items; percent error $5\%$.
4. Absolute error $6$ mL; percent error $5\%$.
5. $285$ g through $315$ g, inclusive.
6. No. Both have $5\%$ error.
7. Absolute error $2$ cm; percent error $\frac{10}{3}\%$.
8. Largest estimate $82$ cm.

## Step-by-Step Solutions

Follow each calculation, then check your own work.

### Problem 1

1. Absolute error: $|48 - 50| = 2$ cm.
2. Use the accepted value $50$ cm as the denominator: $2/50 = \frac{1}{25}$.
3. The percent-error number is $\frac{1}{25}(100) = 4$; therefore the error is $4\%$.

### Problem 2

1. Absolute error: $|84 - 80| = 4$ g.
2. Use the accepted value $80$ g as the denominator: $4/80 = \frac{1}{20}$.
3. The percent-error number is $\frac{1}{20}(100) = 5$; therefore the error is $5\%$.

### Problem 3

1. Absolute error: $|95 - 100| = 5$ items.
2. Use the accepted value $100$ items as the denominator: $5/100 = \frac{1}{20}$.
3. The percent-error number is $\frac{1}{20}(100) = 5$; therefore the error is $5\%$.

### Problem 4

1. Absolute error: $|126 - 120| = 6$ mL.
2. Use the accepted value $120$ mL as the denominator: $6/120 = \frac{1}{20}$.
3. The percent-error number is $\frac{1}{20}(100) = 5$; therefore the error is $5\%$.

### Problem 5

1. Maximum absolute error: $300(5/100) = 15$ g.
2. Lower estimate: $300 - 15 = 285$ g.
3. Upper estimate: $300 + 15 = 315$ g.

### Problem 6

1. Low estimate error: $|285 - 300| = 15$ cm.
2. High estimate error: $|315 - 300| = 15$ cm.
3. Both use denominator $300$, so the percent-error number is $(15/300)100 = 5$; each estimate has $5\%$ error.

### Problem 7

1. Absolute error: $|58 - 60| = 2$ cm.
2. Use the accepted value $60$ cm as the denominator: $2/60 = \frac{1}{30}$.
3. The percent-error number is $\frac{1}{30}(100) = \frac{10}{3}$; therefore the error is $\frac{10}{3}\%$.

### Problem 8

1. Maximum absolute error $80(0.025) = 2$ cm.
2. Largest estimate $80 + 2 = 82$ cm.
3. Check the percent-error number $|82 - 80|/80 \times 100 = 2.5$, so the error is $2.5\%$, exactly the allowed limit.

TESTINAR

# Keep Building Grade 7 Math Skills

Choose the practice book matched to your state assessment and turn worksheet practice into a complete test-prep plan.

All Grade 7 books




TEXAS STAAR

## 10 Full-Length Math Practice Tests

Build Grade 7 accuracy, confidence, and test stamina with 10 printable practice tests.

**Printable eBook • Instant PDF access**

View eBook




FLORIDA FAST

## 10 Full-Length Math Practice Tests

Build Grade 7 accuracy, confidence, and test stamina with 10 printable practice tests.

**Printable eBook • Instant PDF access**

View eBook




CALIFORNIA CAASPP

## 10 Full-Length Math Practice Tests

Build Grade 7 accuracy, confidence, and test stamina with 10 printable practice tests.

**Printable eBook • Instant PDF access**

View eBook

**Need a different state?**
Testinar has Grade 7 math practice books for state assessments across the country.

TESTINAR.COM/GRADES/7