Applying Proportional Reasoning to Real-World Problems

Explore ideas and representations

Name _____ **Date** _____ **Score** _____ / 8

QUICK REVIEW

Keep matching quantities in the same order. Multiply both sides of a ratio by one scale factor, or find the unit rate. If 3 cups serve 4 people, 10 people need $(3/4)(10) = 7.5$ cups, not $3 + 6 = 9$ cups.

Worked example

A recipe uses 3 units in 4 serving. Find units per serving.

1. The unit rate is $3 \div 4$.
2. Use the reciprocal: $3 \times \frac{1}{4} = \frac{3}{4}$.
3. Check: $\frac{3}{4} \times 4 = 3$ units.
Answer: $\frac{3}{4}$ units per serving.

Practice Problems

Show your thinking.

1. A recipe uses 3 cups of flour for 2 servings. Complete the ratio table for 4 servings.

servings	cups of flour
2	3
4	?

2. A garden mix uses 4 kg of seed for 3 beds. Complete the ratio table for 5 beds.

beds	kg of seed
3	4
5	?

3. A paint mix uses 5 liters of blue for 4 cans. Complete the ratio table for 6 cans.

cans	liters of blue
4	5
6	?

4. A fundraiser uses 6 dollars for 5 tickets. Complete the ratio table for 7 tickets.

tickets	dollars
5	6
7	?

5. A fabric job uses 7 meters for 6 flags. Complete the ratio table for 8 flags.

flags	meters
6	7
8	?

6. A water filter uses 8 liters for 7 minutes. Complete the ratio table for 9 minutes.

minutes	liters
7	8
9	?

7. Soup recipe: $\frac{5}{2}$ kg serves 4 groups. Scale the recipe for 10 groups.

8. Trail supply: $\frac{9}{4}$ kg serves 3 groups. Scale the recipe for 8 groups.

Answer Key

1. Need 6 cups of flour.
2. Need $\frac{20}{3}$ kg of seed.
3. Need $\frac{15}{2}$ liters of blue.
4. Need $\frac{42}{5}$ dollars.
5. Need $\frac{28}{3}$ meters.
6. Need $\frac{72}{7}$ liters.
7. $\frac{25}{4}$ kg.
8. 6 kg.

Step-by-Step Solutions

Follow each calculation, then check your own work.

Problem 1

1. Per servings: $3 \div 2 = \frac{3}{2}$ cups of flour.
2. For 4 servings: $\frac{3}{2}(4) = 6$ cups of flour.
3. Check $6 \div 4 = \frac{3}{2}$.

Problem 2

1. Per beds: $4 \div 3 = \frac{4}{3}$ kg of seed.
2. For 5 beds: $\frac{4}{3}(5) = \frac{20}{3}$ kg of seed.
3. Check $\frac{20}{3} \div 5 = \frac{4}{3}$.

Problem 3

1. Per cans: $5 \div 4 = \frac{5}{4}$ liters of blue.
2. For 6 cans: $\frac{5}{4}(6) = \frac{15}{2}$ liters of blue.
3. Check $\frac{15}{2} \div 6 = \frac{5}{4}$.

Problem 4

1. Per tickets: $6 \div 5 = \frac{6}{5}$ dollars.
2. For 7 tickets: $\frac{6}{5}(7) = \frac{42}{5}$ dollars.
3. Check $\frac{42}{5} \div 7 = \frac{6}{5}$.

Problem 5

1. Per flags: $7 \div 6 = \frac{7}{6}$ meters.
2. For 8 flags: $\frac{7}{6}(8) = \frac{28}{3}$ meters.
3. Check $\frac{28}{3} \div 8 = \frac{7}{6}$.

Problem 6

1. Per minutes: $8 \div 7 = \frac{8}{7}$ liters.
2. For 9 minutes: $\frac{8}{7}(9) = \frac{72}{7}$ liters.
3. Check $\frac{72}{7} \div 9 = \frac{8}{7}$.

Problem 7

1. Per group: $\frac{5}{2} \div 4 = \frac{5}{8}$ kg.
2. For 10 groups: $\frac{5}{8}(10) = \frac{25}{4}$ kg.
3. Reverse check: $\frac{25}{4} \div (\frac{5}{8}) = 10$ groups.

Problem 8

1. Per group: $\frac{9}{4} \div 3 = \frac{3}{4}$ kg.
2. For 8 groups: $\frac{3}{4}(8) = 6$ kg.
3. Reverse check: $6 \div (\frac{3}{4}) = 8$ groups.

TESTINAR

Keep Building Grade 7 Math Skills

Choose the practice book matched to your state assessment and turn worksheet practice into a complete test-prep plan.

All Grade 7 books



TEXAS STAAR

10 Full-Length Math Practice Tests

Build Grade 7 accuracy, confidence, and test stamina with 10 printable practice tests.

Printable eBook • Instant PDF access

View eBook



FLORIDA FAST

10 Full-Length Math Practice Tests

Build Grade 7 accuracy, confidence, and test stamina with 10 printable practice tests.

Printable eBook • Instant PDF access

View eBook



CALIFORNIA CAASPP

10 Full-Length Math Practice Tests

Build Grade 7 accuracy, confidence, and test stamina with 10 printable practice tests.

Printable eBook • Instant PDF access

View eBook

Need a different state?
Testinar has Grade 7 math practice books for state assessments across the country.

TESTINAR.COM/GRADES/7