Word Problems with Fraction Addition and Subtraction

Word Problems with Fraction Addition and Subtraction: Models and Computation

Name _____ **Date** _____ **Score** _____ / 8

QUICK REVIEW

Combine lengths or amounts with addition; find what remains or what is missing with subtraction. Use a common unit. For $\frac{1}{2}$ L plus $\frac{1}{3}$ L, $\frac{3}{6}+\frac{2}{6}=\frac{5}{6}$ L. Units belong to the result, not the denominator.

Worked example

A container holds $\frac{3}{5}$ L. Another $\frac{1}{4}$ L is added. How much is in the container now?

1. The quantities call for $\frac{3}{5}+\frac{1}{4}$; the result is measured in L.
2. A common denominator is 20: $\frac{3}{5}=\frac{12}{20}$ and $\frac{1}{4}=\frac{5}{20}$.
3. $\frac{3}{5}+\frac{1}{4}=\frac{12+5}{20}=\frac{17}{20}$.
4. Simplify to $\frac{17}{20}$; check $\frac{17}{20}-\frac{1}{4}=\frac{3}{5}$.

Answer: $\frac{17}{20}$ L.

Practice Problems

Show your thinking.

1. A walker travels $\frac{3}{8}$ km, then $\frac{1}{3}$ km. Find the total distance.

2. A $\frac{7}{8}$ m strip loses a $\frac{1}{3}$ m piece. Find the remaining length.

3. A jug has $\frac{3}{4}$ L. Add $\frac{2}{3}$ L, then pour out $\frac{1}{2}$ L. How much is left?

4. Correct: A $\frac{2}{3}$ m red ribbon and a $\frac{1}{4}$ m blue ribbon total $\frac{3}{7}$ m.

5. Find the missing number: $\frac{5}{6}-\square=\frac{7}{12}$. Check by substitution.

6. A recipe needs $1\frac{1}{2}$ cups of oats. You have $\frac{5}{8}$ cup. How much more is needed?

7. A route is $2\frac{1}{3}$ km. You have walked $\frac{3}{4}$ km. Is the remaining distance greater than $1\frac{1}{2}$ km? Find the gap.

8. Design a 1 L mixture using $\frac{2}{5}$ L of juice and the rest water. Find the water needed.

Answer Key

1. $\frac{17}{24}$ km.
2. $\frac{13}{24}$ m.
3. $\frac{11}{12}$ L.
4. $\frac{11}{12}$ m.
5. $\frac{1}{4}$.
6. $\frac{7}{8}$ cup.
7. Yes; $\frac{1}{12}$ km greater.
8. $\frac{3}{5}$ L.

Step-by-Step Solutions

Follow each calculation, then check your own work.

Problem 1

1. The quantities call for $\frac{3}{8} + \frac{1}{3}$; the result is measured in km.
2. A common denominator is 24: $\frac{3}{8} = \frac{9}{24}$ and $\frac{1}{3} = \frac{8}{24}$.
3. $\frac{3}{8} + \frac{1}{3} = \frac{9+8}{24} = \frac{17}{24}$.
4. Simplify to $\frac{17}{24}$; check $\frac{17}{24} - \frac{1}{3} = \frac{3}{8}$.

Problem 2

1. The quantities call for $\frac{7}{8} - \frac{1}{3}$; the result is measured in m.
2. A common denominator is 24: $\frac{7}{8} = \frac{21}{24}$ and $\frac{1}{3} = \frac{8}{24}$.
3. $\frac{7}{8} - \frac{1}{3} = \frac{21-8}{24} = \frac{13}{24}$.
4. Simplify to $\frac{13}{24}$; check $\frac{13}{24} + \frac{1}{3} = \frac{7}{8}$.

Problem 3

1. First combine: $\frac{3}{4} + \frac{2}{3} = \frac{9}{12} + \frac{8}{12} = \frac{17}{12}$ L.
2. Then remove $\frac{1}{2} = \frac{6}{12}$ L: $\frac{17}{12} - \frac{6}{12} = \frac{11}{12}$ L.
3. Check: $\frac{11}{12} + \frac{1}{2} = \frac{17}{12}$ L.

Problem 4

1. Use twelfths: $\frac{2}{3} = \frac{8}{12}$ and $\frac{1}{4} = \frac{3}{12}$.
2. $\frac{8}{12} + \frac{3}{12} = \frac{11}{12}$ m.
3. A sum of positive lengths must exceed $\frac{2}{3}$; $\frac{3}{7}$ does not.

Problem 5

1. Undo the known operation to find the missing value: $\frac{5}{6} - \frac{7}{12} = \frac{1}{4}$.
2. A common denominator is 12: $\frac{5}{6} = \frac{10}{12}$ and $\frac{1}{4} = \frac{3}{12}$.
3. $\frac{5}{6} - \frac{1}{4} = \frac{10-3}{12} = \frac{7}{12}$.
4. Simplify to $\frac{7}{12}$; check $\frac{7}{12} + \frac{1}{4} = \frac{5}{6}$.

Problem 6

1. $1\frac{1}{2} = \frac{12}{8}$ cups.
2. $\frac{12}{8} - \frac{5}{8} = \frac{7}{8}$ cup.
3. $\frac{5}{8} + \frac{7}{8} = \frac{12}{8}$ cups checks the total.

Problem 7

1. Remaining: $\frac{7}{3} - \frac{3}{4} = \frac{28}{12} - \frac{9}{12} = \frac{19}{12}$ km.
2. $1\frac{1}{2} = \frac{18}{12}$ km.
3. $\frac{19}{12} - \frac{18}{12} = \frac{1}{12}$ km.

Problem 8

1. $1 = \frac{5}{5}$ L.
2. Water is $\frac{5}{5} - \frac{2}{5} = \frac{3}{5}$ L.
3. $\frac{2}{5} + \frac{3}{5} = 1$ L verifies the design.

TESTINAR

Keep Building Grade 5 Math Skills

Choose the practice book matched to your state assessment and turn worksheet practice into a complete test-prep plan.

All Grade 5 books



TEXAS STAAR

10 Full-Length Math Practice Tests

Build Grade 5 accuracy, confidence, and test stamina with 10 printable practice tests.

Printable eBook • Instant PDF access

View eBook

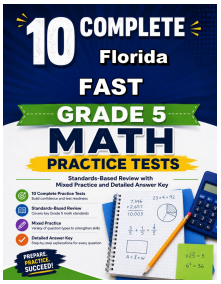

FLORIDA FAST

10 Full-Length Math Practice Tests

Build Grade 5 accuracy, confidence, and test stamina with 10 printable practice tests.

Printable eBook • Instant PDF access

View eBook



CALIFORNIA CAASPP

10 Full-Length Math Practice Tests

Build Grade 5 accuracy, confidence, and test stamina with 10 printable practice tests.

Printable eBook • Instant PDF access

View eBook

Need a different state?
Testinar has Grade 5 math practice books for state assessments across the country.

TESTINAR.COM/GRADES/5