Area with Fractional Side Lengths

Area with Fractional Side Lengths: Models and Computation

Name _____ **Date** _____ **Score** _____ / 6

QUICK REVIEW

Rectangle area is $A = l \times w$, even when the side lengths are fractions. Multiply the numerators and the denominators, then simplify. The result is in square meters because it counts parts of a one-meter-by-one-meter square.

Worked example

Find the area of the rectangle. Its side lengths are $\frac{5}{6}$ m and $\frac{3}{10}$ m.

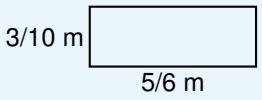

1. Area is length times width: $A = \frac{5}{6} \times \frac{3}{10}$.

2. $5 \times 3 = 15$ and $6 \times 10 = 60$.

3. $A = \frac{15}{60} = \frac{1}{4}$ m^2.

Answer: $\frac{1}{4}$ m^2.

Practice Problems

Show your thinking.

1. Find the area of the rectangle. Its side lengths are $\frac{3}{4}$ m and $\frac{2}{3}$ m.

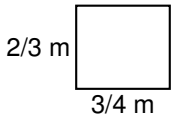

2. The pictured rectangle is $1\frac{1}{4}$ m by $\frac{3}{5}$ m. Find its area in square meters, not its perimeter.

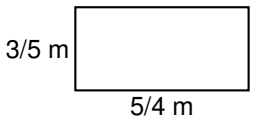

3. A student adds the side lengths $1\frac{1}{6}$ m and $\frac{3}{4}$ m to find area. Correct the operation and the unit.

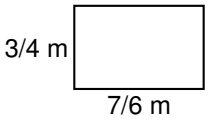

4. A rectangular mat has area $\frac{4}{3}$ m^2 and width $\frac{4}{5}$ m. Find its length.



5. A rectangular patch is $\frac{9}{4}$ m by $\frac{2}{3}$ m. Is its area less than $\frac{7}{4}$ m^2? Find the gap.

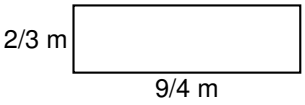

6. Find the area of the rectangle. Its side lengths are $1\frac{2}{5}$ m and $\frac{5}{6}$ m.

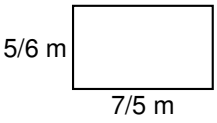

Answer Key

1. $\frac{1}{2}$ m^2.
2. $\frac{3}{4}$ m^2.
3. $\frac{7}{8}$ m^2.
4. $1\frac{2}{3}$ m.
5. Yes; by $\frac{1}{4}$ m^2.
6. $1\frac{1}{6}$ m^2.

Step-by-Step Solutions

Follow each calculation, then check your own work.

Problem 1

1. Area is length times width: $A = \frac{3}{4} \times \frac{2}{3}$.
2. $3 \times 2 = 6$ and $4 \times 3 = 12$.
3. $A = \frac{6}{12} = \frac{1}{2}$ m^2.

Problem 2

1. Area is length times width: $A = \frac{5}{4} \times \frac{3}{5}$.
2. $5 \times 3 = 15$ and $4 \times 5 = 20$.
3. $A = \frac{15}{20} = \frac{3}{4}$ m^2.

Problem 3

1. Area is length times width: $A = \frac{7}{6} \times \frac{3}{4}$.
2. $7 \times 3 = 21$ and $6 \times 4 = 24$.
3. $A = \frac{21}{24} = \frac{7}{8}$ m^2.

Problem 4

1. Split the known width into 4 strips of $\frac{1}{5}$ m. Each strip has area $\frac{4}{3} \div 4 = \frac{1}{3}$ square meters.
2. 5 such strips span 1 m and cover $5 \times \frac{1}{3} = \frac{5}{3}$ square meters. So the length is $\frac{5}{3}$ m.
3. Check: $\frac{5}{3} \times \frac{4}{5} = \frac{4}{3}$ square meters.

Problem 5

1. Area is length times width: $A = \frac{9}{4} \times \frac{2}{3}$.
2. $9 \times 2 = 18$ and $4 \times 3 = 12$.
3. $A = \frac{18}{12} = \frac{3}{2}$ m^2.
4. $\frac{7}{4} - \frac{3}{2} = \frac{1}{4}$ m^2.

Problem 6

1. Area is length times width: $A = \frac{7}{5} \times \frac{5}{6}$.
2. $7 \times 5 = 35$ and $5 \times 6 = 30$.
3. $A = \frac{35}{30} = \frac{7}{6}$ m^2.

TESTINAR

Keep Building Grade 5 Math Skills

Choose the practice book matched to your state assessment and turn worksheet practice into a complete test-prep plan.

All Grade 5 books



TEXAS STAAR

10 Full-Length Math Practice Tests

Build Grade 5 accuracy, confidence, and test stamina with 10 printable practice tests.

Printable eBook • Instant PDF access

View eBook

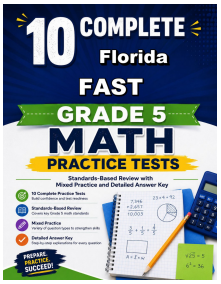

FLORIDA FAST

10 Full-Length Math Practice Tests

Build Grade 5 accuracy, confidence, and test stamina with 10 printable practice tests.

Printable eBook • Instant PDF access

View eBook



CALIFORNIA CAASPP

10 Full-Length Math Practice Tests

Build Grade 5 accuracy, confidence, and test stamina with 10 printable practice tests.

Printable eBook • Instant PDF access

View eBook

Need a different state?
Testinar has Grade 5 math practice books for state assessments across the country.

TESTINAR.COM/GRADES/5