3rd Grade Math Workbook 2018

2 Complete PSSA Math Practice Tests

PSSA

The Only Book
Your student will Ever Need
to ACE the PSSA Math Exam!

Reza Nazari & Ava Ross

Let's Keep in Touch

Follow Us Online

Visit US at

www.EffortlessMath.com

https://www.facebook.com/Effortlessmath

https://goo.gl/2B6qWW

Online Math Lessons

It's easy! Here's how it works.

1- Request a FREE introductory session.

2- Meet a Math tutor online.

3- Start Learning Math in Minutes.

Send Email to: info@EffortlessMath.com

www.EffortlessMath.com

… So Much More Online!

- **FREE Math lessons**
- **More Math learning books!**
- **Online Math Tutors**

Looking for an Online Math Tutor?

Send Email to: info@EffortlessMath.com

3rd Grade PSSA Math Workbook 2018

The Most Comprehensive Review for the Math Section of the PSSA TEST

By

Reza Nazari

& Ava Ross

Copyright © 2018

Reza Nazari & Ava Ross

All rights reserved. No part of this publication may be reproduced, stored in a retrieval system, or transmitted in any form or by any means, electronic, mechanical, photocopying, recording, scanning, or otherwise, except as permitted under Section 107 or 108 of the 1976 United States Copyright Ac, without permission of the author.

All inquiries should be addressed to:

info@effortlessMath.com

www.EffortlessMath.com

ISBN-13: 978-1986278157

ISBN-10: 1986278158

Published by: Effortless Math Education

www.EffortlessMath.com

Description

Effortless Math PSSA Workbook provides students with the confidence and math skills they need to succeed on the PSSA Math, providing a solid foundation of basic Math topics with abundant exercises for each topic. It is designed to address the needs of PSSA test takers who must have a working knowledge of basic Math.

This comprehensive workbook with over 1,500 sample questions and 2 complete 3rd Grade PSSA tests is all your student needs to fully prepare for the PSSA Math. It will help your student learns everything they need to ace the math section of the PSSA.

There are more than 1,500 Math problems with answers in this book.
Effortless Math unique study program provides your student with an in–depth focus on the math portion of the exam, helping them master the math skills that students find the most troublesome.
This workbook contains most common sample questions that are most likely to appear in the mathematics section of the PSSA.

Inside the pages of this comprehensive workbook, students can learn basic math operations in a structured manner with a complete study program to help them understand essential math skills. It also has many exciting features, including:

- Dynamic design and easy–to–follow activities
- A fun, interactive and concrete learning process
- Targeted, skill–building practices
- Fun exercises that build confidence
- Math topics are grouped by category, so the students can focus on the topics they struggle on
- All solutions for the exercises are included, so you will always find the answers
- 2 Complete PSSA Math Practice Tests that reflect the format and question types on PSSA

Effortless Math PSSA Workbook is an incredibly useful tool for those who want to review all topics being covered on the PSSA test. It efficiently and effectively reinforces learning outcomes through engaging questions and repeated practice, helping students to quickly master basic Math skills.



About the Author

Reza Nazari is the author of more than 100 Math learning books including:

– Math for Super Smart Students: Fifth Graders and Older by Reza Nazari

– Math and Critical Thinking Challenges: For the Middle and High School Student

– Effortless Math Education Workbooks

Reza is also an experienced Math instructor and a test–prep expert who has been tutoring students since 2008. Reza is the founder of Effortless Math Education, a tutoring company that has helped many students raise their Math knowledge—and succeed in their studies. Reza provides an individualized custom learning plan and the personalized attention that makes a difference in how students view math.

You can contact Reza via email at:
Reza@EffortlessMath.com

Find Reza's professional profile at:
goo.gl/zoC9rJ

Contents

Repeating pattern 13
Growing Patterns 15
Adding Two–Digit Numbers 17
Subtracting Two–Digit Numbers 19
Adding Three–Digit Numbers 21
Calendars 23
Adding Hundreds 25
Round 3–Digit Numbers 27
Adding 4–Digit Numbers 29
Subtracting 4–Digit Numbers 31
Estimate Sums 33
Estimate Differences 35
Estimate Products 37
Fractions 39
Fractions of a Number 41
Order Fractions 43
Value of "x" 45
Comparing Numbers 47
Adding Decimal Numbers 49
Positions 51
Read Clocks 53
Electronic Clock 55
Multiplication by 0, 1, 2 , and 3 57
Multiplication by 4, 5, 6 59
Multiplication by 7, 8, 9 61
Multiplication by 10, 11, 12 63
Division by 0, 1, 2, 3 65

Division by 4, 5, 6 67
Division by 7, 8, 9 69
Division by 10, 11, 12 71
Measurement 73
Weights 75
Volume 77
Centimeters & Millimeters 79
Kilograms & Grams 81
Liters & Milliliters 83
Missing Denominator or Numerator 85
Roman Numerals 87
Simplifying Fractions 89
Triangles 91
Geometry 93
Quadrilaterals 95
Order of Operations 97
Order the Numbers 99
Improper Fraction 101
Dividing by Tens 103
Divide 3–Digit Numbers By 1-Digit Numbers 105
Multiply 1digit By 3–Digit Numbers 107
Comparing Fractions 109
Division by Hundred 111
Missing Numbers 113
Triangles And Quadrilaterals 115
Acute, Obtuse, And Right Triangles 116
Parallel Sides in Quadrilaterals 117
Identify Parallelograms 118

Identify Trapezoids.....119
Identify Rectangles.....120
Identify Rhombuses.....121
Identify Two–Dimensional Shapes.....122
PSSA Practice Test 1.....123
PSSA Practice Test 2.....141
PSSA Practice Tests Answer Keys.....157
Answers of Worksheets.....158

Repeating pattern

Circle the picture that comes next in each picture pattern.

1)



2)



3)



4)



5)





6)





7)





8)



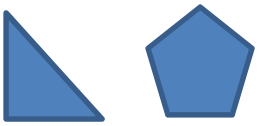

Growing Patterns

Draw the picture that comes next in each growing pattern.

1)

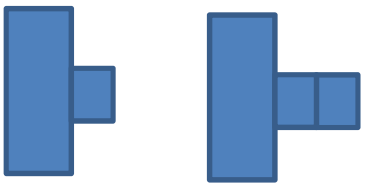

2)

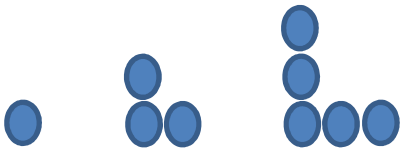

3)



4)



5)

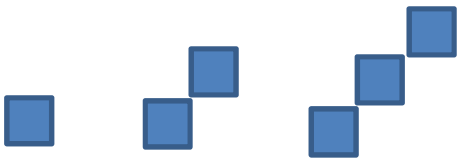

6)



7)



8)



Adding Two–Digit Numbers

Find each sum.

1. $\begin{array}{r} 50 \\ +\ 18 \\ \hline \end{array}$

2. $\begin{array}{r} 32 \\ +\ 14 \\ \hline \end{array}$

3. $\begin{array}{r} 45 \\ +\ 16 \\ \hline \end{array}$

4. $\begin{array}{r} 12 \\ +\ 12 \\ \hline \end{array}$

5. $\begin{array}{r} 43 \\ +\ 30 \\ \hline \end{array}$

6. $\begin{array}{r} 34 \\ +\ 15 \\ \hline \end{array}$

7. $\begin{array}{r} 89 \\ +\ 7 \\ \hline \end{array}$

8. $\begin{array}{r} 63 \\ +\ 12 \\ \hline \end{array}$

9. $\begin{array}{r} 90 \\ +\ 10 \\ \hline \end{array}$

Add.

10. 14 + 14 = ——

11. 16 + 18 = ——

12. 56 + 17 = ——

13. 89 + 20 = ——

14. 34 + 20 = ——

15. 53 + 30 = ——

16. 95 + 15 = ——

17. 85 + 10 = —

18. 70 + 10 = —

19. 20 + 10 = ——

20. 15 + 15 = ——

21. 39 + 19 = ——

22. 48 + 12 = ——

23. 29 + 34 = ——

Subtracting Two–Digit Numbers

Find each difference.

1. $\begin{array}{r} 32 \\ -15 \\ \hline \\ \end{array}$

2. $\begin{array}{r} 40 \\ -12 \\ \hline \\ \end{array}$

3. $\begin{array}{r} 67 \\ -17 \\ \hline \\ \end{array}$

4. $\begin{array}{r} 18 \\ -10 \\ \hline \\ \end{array}$

5. $\begin{array}{r} 59 \\ -16 \\ \hline \\ \end{array}$

6. $\begin{array}{r} 89 \\ -20 \\ \hline \\ \end{array}$

7. $\begin{array}{r} 78 \\ -21 \\ \hline \\ \end{array}$

8. $\begin{array}{r} 66 \\ -15 \\ \hline \\ \end{array}$

9. $\begin{array}{r} 87 \\ -45 \\ \hline \\ \end{array}$

Subtract.

10. 75 – 25 = ——

11. 47 – 37 = ——

12. 92 – 16 = ——

13. 78 – 37 = ——

14. 45 – 20 = ——

15. 66 – 23 = ——

16. 99 – 68 = ——

17. 95 – 40 = —

18. 83 – 51 = —

19. 61 – 48 = ——

20. 42 – 15 = ——

21. 84 – 67 = ——

22. 58 – 22 = ——

23. 63 – 23 = ——