3rd Grade Math Workbook 2018

PARCC

The Most Comprehensive Review for the Math Section of the PARCC

Reza Nazari & Ava Ross

Let's Keep in Touch

Follow Us Online

Visit US at

www.EffortlessMath.com

https://www.facebook.com/Effortlessmath

https://goo.gl/2B6qWW

Online Math Lessons

It's easy! Here's how it works.

1- Request a FREE introductory session.

2- Meet a Math tutor online.

3- Start Learning Math in Minutes.

Send Email to: info@EffortlessMath.com

www.EffortlessMath.com

… So Much More Online!

- **FREE Math lessons**
- **More Math learning books!**
- **Online Math Tutors**

Looking for an Online Math Tutor?

Send Email to: info@EffortlessMath.com

3rd Grade PARCC Math Workbook 2018

The Most Comprehensive Review for the Math Section of the PARCC TEST

By

Reza Nazari

& Ava Ross

Copyright © 2018

Reza Nazari & Ava Ross

All rights reserved. No part of this publication may be reproduced, stored in a retrieval system, or transmitted in any form or by any means, electronic, mechanical, photocopying, recording, scanning, or otherwise, except as permitted under Section 107 or 108 of the 1976 United States Copyright Ac, without permission of the author.

All inquiries should be addressed to:

info@effortlessMath.com

www.EffortlessMath.com

ISBN-13: 978-1986279482

ISBN-10: 1986279480

Published by: Effortless Math Education

www.EffortlessMath.com

Description

Effortless Math PARCC Workbook provides students with the confidence and math skills they need to succeed on the PARCC Math, providing a solid foundation of basic Math topics with abundant exercises for each topic. It is designed to address the needs of PARCC test takers who must have a working knowledge of basic Math.

This comprehensive workbook with over 1,500 sample questions and 2 complete 3rd Grade PARCC tests is all your student needs to fully prepare for the PARCC Math. It will help your student learns everything they need to ace the math section of the PARCC.

Effortless Math unique study program provides your student with an in-depth focus on the math portion of the exam, helping them master the math skills that students find the most troublesome.
This workbook contains most common sample questions that are most likely to appear in the mathematics section of the PARCC.

Inside the pages of this comprehensive workbook, students can learn basic math operations in a structured manner with a complete study program to help them understand essential math skills. It also has many exciting features, including:

- Dynamic design and easy-to-follow activities
- A fun, interactive and concrete learning process

- Targeted, skill-building practices
- Fun exercises that build confidence
- Math topics are grouped by category, so the students can focus on the topics they struggle on
- All solutions for the exercises are included, so you will always find the answers
- 2 Complete PARCC Math Practice Tests that reflect the format and question types on PARCC

Effortless Math PARCC Workbook is an incredibly useful tool for those who want to review all topics being covered on the PARCC test. It efficiently and effectively reinforces learning outcomes through engaging questions and repeated practice, helping students to quickly master basic Math skills.



About the Author

Reza Nazari is the author of more than 100 Math learning books including:

– Math for Super Smart Students: Fifth Graders and Older by Reza Nazari

– Math and Critical Thinking Challenges: For the Middle and High School Student

– Effortless Math Education Workbooks

Reza is also an experienced Math instructor and a test–prep expert who has been tutoring students since 2008. Reza is the founder of Effortless Math Education, a tutoring company that has helped many students raise their Math knowledge—and succeed in their studies. Reza provides an individualized custom learning plan and the personalized attention that makes a difference in how students view math.

You can contact Reza via email at:
Reza@EffortlessMath.com

Find Reza's professional profile at:
goo.gl/zoC9rJ

Contents

Repeating pattern 12
Growing Patterns 14
Adding Two–Digit Numbers 16
Subtracting Two–Digit Numbers 18
Adding Three–Digit Numbers 20
Calendars 22
Adding Hundreds 24
Round 3–Digit Numbers 26
Adding 4–Digit Numbers 28
Subtracting 4–Digit Numbers 30
Estimate Sums 32
Estimate Differences 34
Estimate Products 36
Fractions 38
Fractions of a Number 40
Order Fractions 42
Value of "x" 44
Comparing Numbers 46
Adding Decimal Numbers 48
Positions 50
Read Clocks 52
Electronic Clock 54
Multiplication by 0, 1, 2 , and 3 56
Multiplication by 4, 5, 6 58
Multiplication by 7, 8, 9 60
Multiplication by 10, 11, 12 62
Division by 0, 1, 2, 3 64

Division by 4, 5, 6 66
Division by 7, 8, 9 68
Division by 10, 11, 12 70
Measurement 72
Weights 74
Volume 76
Centimeters & Millimeters 78
Kilograms & Grams 80
Liters & Milliliters 82
Missing Denominator or Numerator 84
Roman Numerals 86
Simplifying Fractions 88
Triangles 90
Geometry 92
Quadrilaterals 94
Order of Operations 96
Order the Numbers 98
Improper Fraction 100
Dividing by Tens 102
Divide 3–Digit Numbers By 1-Digit Numbers 104
Multiply 1digit By 3–Digit Numbers 106
Comparing Fractions 108
Division by Hundred 110
Missing Numbers 112
Triangles And Quadrilaterals 114
Acute, Obtuse, And Right Triangles 115
Parallel Sides in Quadrilaterals 116
Identify Parallelograms 117

Identify Trapezoids.....118
Identify Rectangles.....119
Identify Rhombuses.....120
Identify Two–Dimensional Shapes.....121
PARCC Practice Test 1.....122
PARCC Practice Test 2.....147
PARCC Practice Tests Answer Keys.....170
Answers of Worksheets.....171

Repeating pattern

Circle the picture that comes next in each picture pattern.

1)



2)



3)



4)



5)





6)





7)





8)



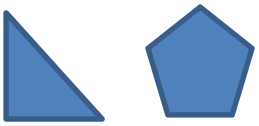

Growing Patterns

Draw the picture that comes next in each growing pattern.

1)

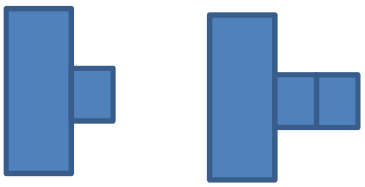

2)

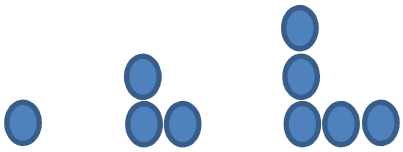

3)



4)



5)

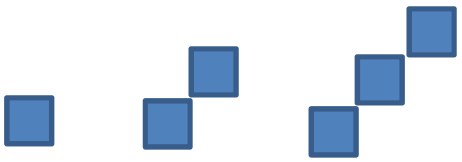

6)



7)



8)



Adding Two–Digit Numbers

Find each sum.

1. $\begin{array}{r} 50 \\ +\ 18 \\ \hline \end{array}$

2. $\begin{array}{r} 32 \\ +\ 14 \\ \hline \end{array}$

3. $\begin{array}{r} 45 \\ +\ 16 \\ \hline \end{array}$

4. $\begin{array}{r} 12 \\ +\ 12 \\ \hline \end{array}$

5. $\begin{array}{r} 43 \\ +\ 30 \\ \hline \end{array}$

6. $\begin{array}{r} 34 \\ +\ 15 \\ \hline \end{array}$

7. $\begin{array}{r} 89 \\ +\ 7 \\ \hline \end{array}$

8. $\begin{array}{r} 63 \\ +\ 12 \\ \hline \end{array}$

9. $\begin{array}{r} 90 \\ +\ 10 \\ \hline \end{array}$

Add.

10. 14 + 14 = ——

11. 16 + 18 = ——

12. 56 + 17 = ——

13. 89 + 20 = ——

14. 34 + 20 = ——

15. 53 + 30 = ——

16. 95 + 15 = ——

17. 85 + 10 = —

18. 70 + 10 = —

19. 20 + 10 = ——

20. 15 + 15 = ——

21. 39 + 19 = ——

22. 48 + 12 = ——

23. 29 + 34 = ——

Subtracting Two–Digit Numbers

Find each difference.

1. $\begin{array}{r} 32 \\ -15 \\ \hline \\ \end{array}$

2. $\begin{array}{r} 40 \\ -12 \\ \hline \\ \end{array}$

3. $\begin{array}{r} 67 \\ -17 \\ \hline \\ \end{array}$

4. $\begin{array}{r} 18 \\ -10 \\ \hline \\ \end{array}$

5. $\begin{array}{r} 59 \\ -16 \\ \hline \\ \end{array}$

6. $\begin{array}{r} 89 \\ -20 \\ \hline \\ \end{array}$

7. $\begin{array}{r} 78 \\ -21 \\ \hline \\ \end{array}$

8. $\begin{array}{r} 66 \\ -15 \\ \hline \\ \end{array}$

9. $\begin{array}{r} 87 \\ -45 \\ \hline \\ \end{array}$

Subtract.

10. 75 – 25 = ——

11. 47 – 37 = ——

12. 92 – 16 = ——

13. 78 – 37 = ——

14. 45 – 20 = ——

15. 66 – 23 = ——

16. 99 – 68 = ——

17. 95 – 40 = —

18. 83 – 51 = —

19. 61 – 48 = ——

20. 42 – 15 = ——

21. 84 – 67 = ——

22. 58 – 22 = ——

23. 63 – 23 = ——

Adding Three–Digit Numbers

Find each sum.

1. $\begin{array}{r} 234 \\ +\ 56 \\ \hline \end{array}$

2. $\begin{array}{r} 523 \\ +\ 134 \\ \hline \end{array}$

3. $\begin{array}{r} 345 \\ +\ 167 \\ \hline \end{array}$

4. $\begin{array}{r} 460 \\ +\ 120 \\ \hline \end{array}$

5. $\begin{array}{r} 432 \\ +\ 430 \\ \hline \end{array}$

6. $\begin{array}{r} 235 \\ +\ 150 \\ \hline \end{array}$

7. $\begin{array}{r} 789 \\ +\ 57 \\ \hline \end{array}$

8. $\begin{array}{r} 863 \\ +\ 340 \\ \hline \end{array}$

9. $\begin{array}{r} 956 \\ +\ 89 \\ \hline \end{array}$